$$D_{9,0}^{(A)} = \frac{\sqrt{113}}{8}\left(-\frac{\overset{28}{M_{9,0}^{(A)}}}{5,5} + \frac{\overset{24}{M_{8,0}^{(A)}}}{4,25}\right) = 0,738994 \qquad -\frac{2,75\sqrt{113}}{34}\overset{8}{H^{(A)}} = -6,878329$$

$$D_{9,0}^{(B)} = \frac{\sqrt{113}}{8}\left(-\frac{\overset{8}{M_{9,0}^{(B)}}}{5,5} + \frac{\overset{12}{M_{8,0}^{(B)}}}{4,25}\right) = 1,819062 \qquad -\frac{2,75\sqrt{113}}{34}\underset{(-8)}{H^{(B)}} = 6,878329$$

D_9

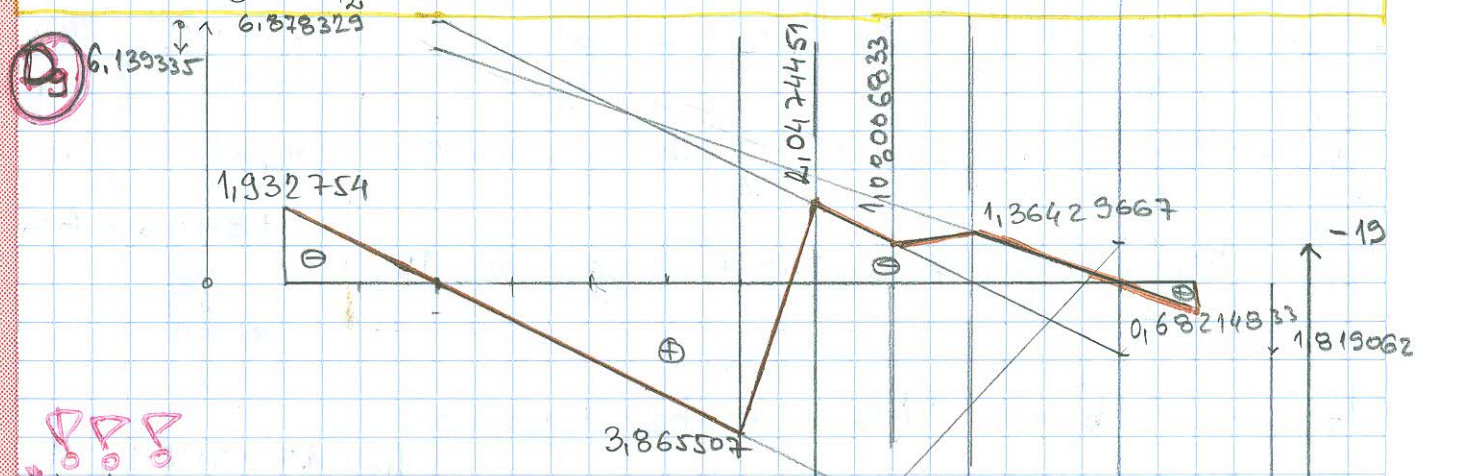

!!!

*Kada je presek iza g onda prvo nanosim $H^{(A)}$ pa $D^{(A)}$ i $D^{(B)}$ pa $H^{(B)}$ isto spajam. Prvu A spajam sa prvom B, ostale idu u 0.

O_4

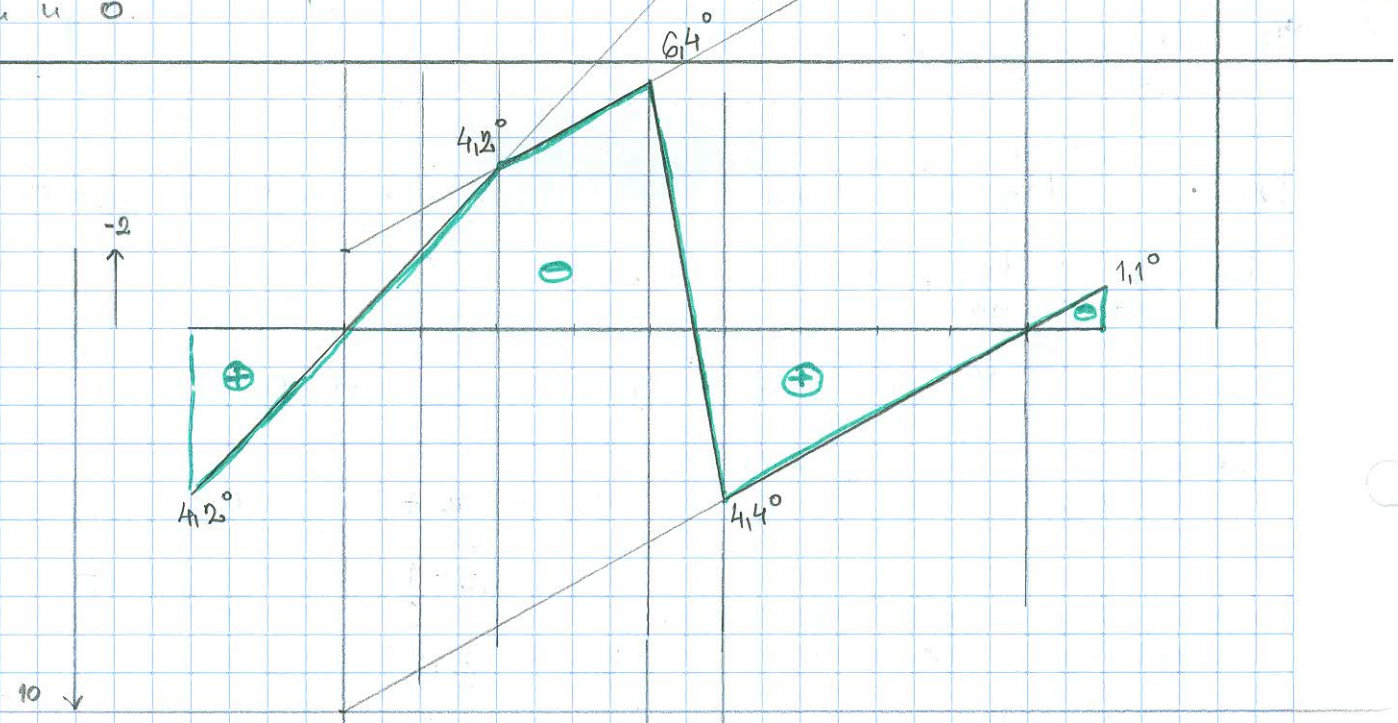

U_7

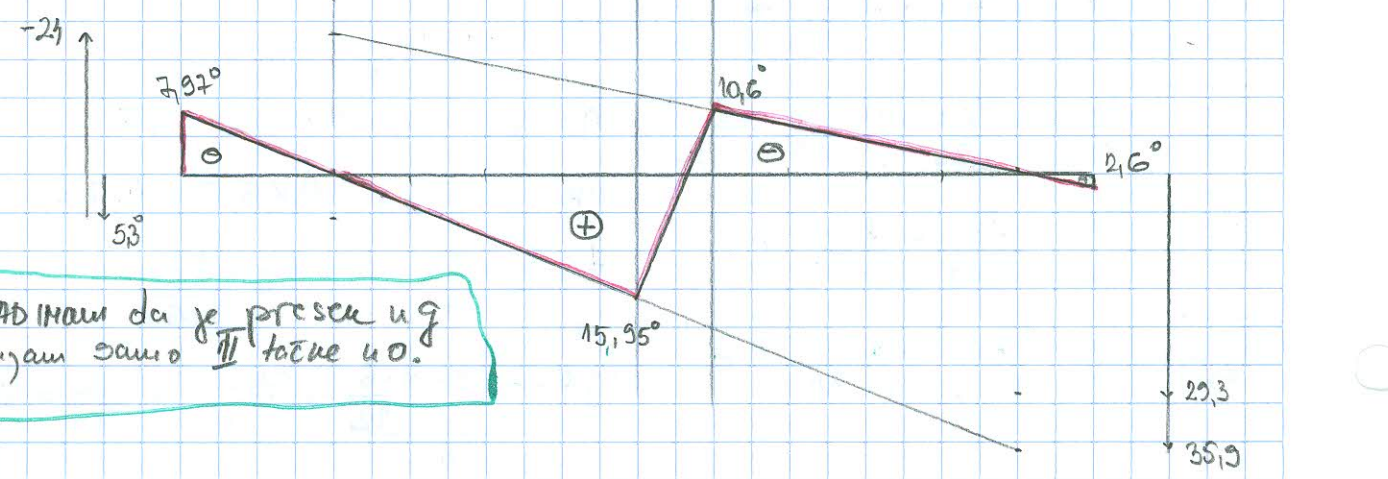

*KADIMAM da je presek u g spajam samo II tačke u 0.